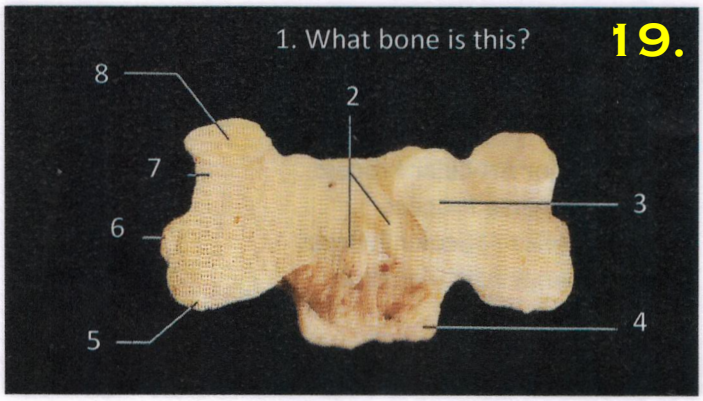
1. What bone is this?
19.
8
2
7
3
6
5
4

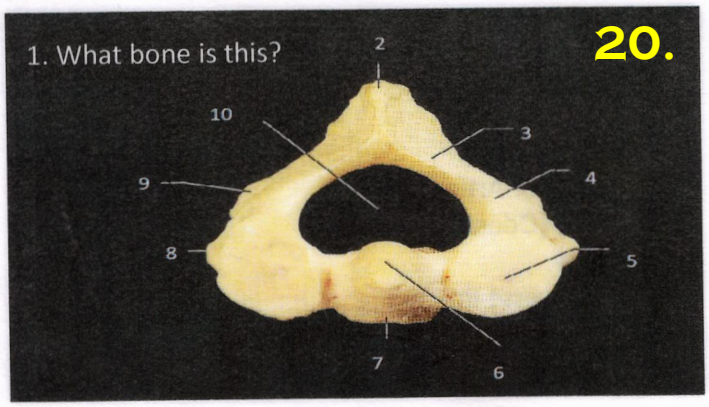
1. What bone is this?
20.
2
10
3
9
4
8
5
7
6

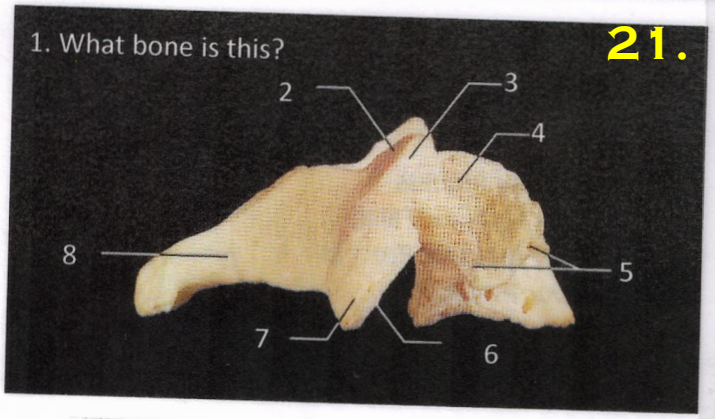
1. What bone is this?
21.
2
3
4
8
5
7
6

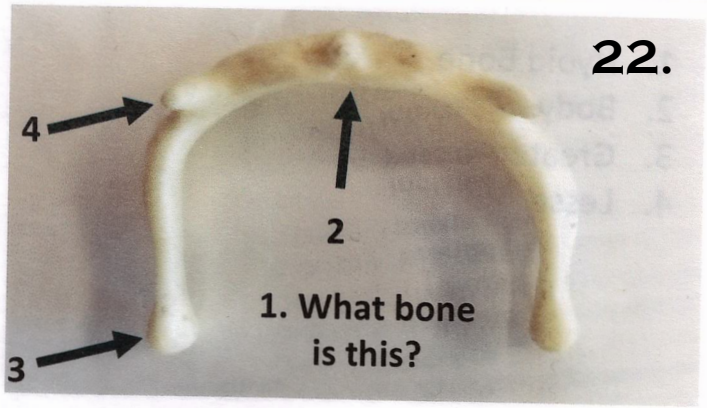
22.
4
2
1. What bone is this?
3

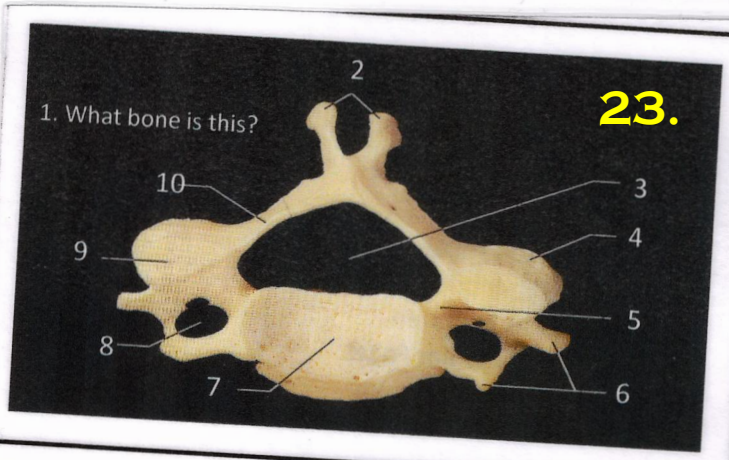
1. What bone is this?
23.
2
10
3
9
4
5
8
7
6

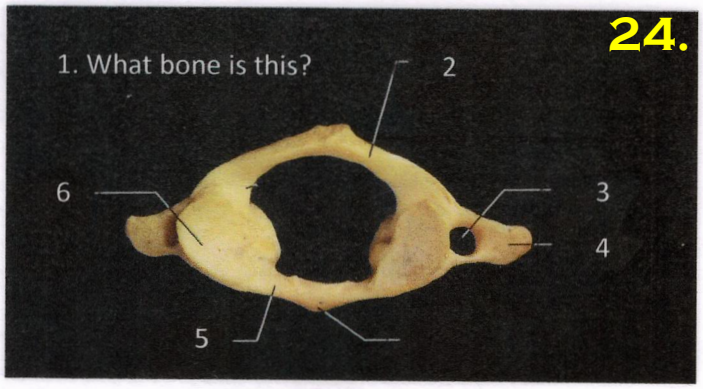
1. What bone is this?
24.
2
6
3
4
5

20.

1. Axis
2. Spinous Process
3. Lamina
4. Pedicle
5. Superior Articular Facet
6. Dens (Odontoid Process)
7. Body
8. Transverse Process
9. Inferior Articular Facet
10. Vertebral Foramen

19.

1. Cervical Vertebrae
2. (Bifid) Spinous Process
3. Lamina
4. Body
5. Inferior Articular Process
6. Transverse Process
7. Superior Articular Process
8. Superior Articular Facet

22.

1. Hyoid Bone
2. Body
3. Greater Horn
4. Lesser Horn

21.

1. Cervical Vertebrae
2. Superior Articular Facet
3. Superior Articular Process
4. Body
5. Transverse Process
6. Inferior Articular Facet
7. Inferior Articular Process
8. Spinous Process

24.

1. Atlas
2. Posterior Arch
3. Transverse Foramen
4. Transverse Process
5. Posterior Arch
6. Superior Articular Facet

23.

1. Cervical Vertebrae
2. (Bifid) Spinous Process
3. Vertebral Foramen
4. Inferior Articular Facet
5. Pedicle
6. Transverse Process
7. Body
8. Transverse Foramen
9. Superior Articular Facet
10. Lamina